次の図で $\ell // m$ のとき、$\angle x$ の大きさを求めなさい。

(1)

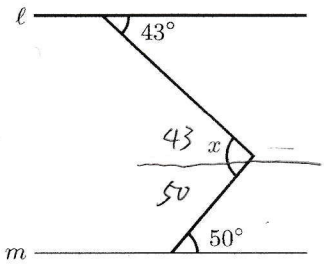

93°

(2)

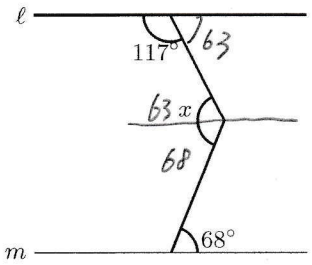

131°

(3)

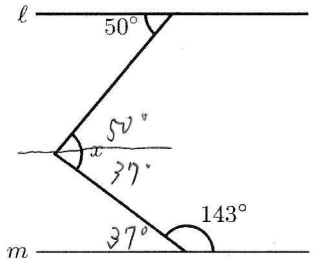

87°

(4)

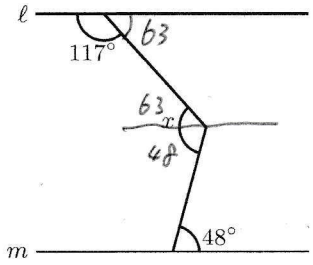

111°

(5)

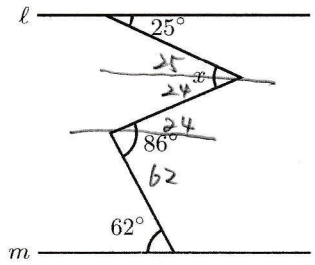

49°

(6)

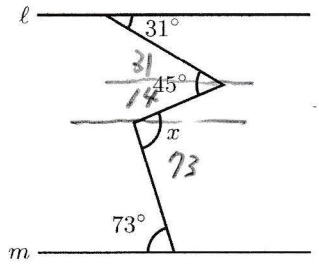

87°